Géométrie	Distance	

③ Lis les phrases. Écris Vrai ou Faux.

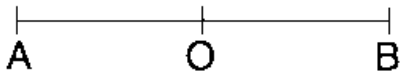

O est au milieu de [AB] .....

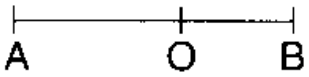

A et B sont équidistants de O .....

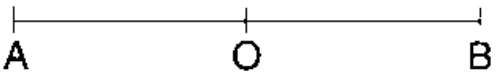

AO = OB .....

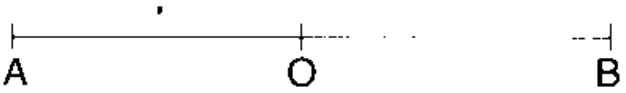

Le milieu du segment [AB] s'appelle O. .....

Géométrie	Distance	

---

② O est-il au milieu de [AB] ? Utilise le compas.
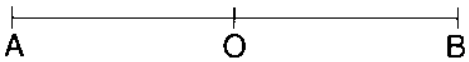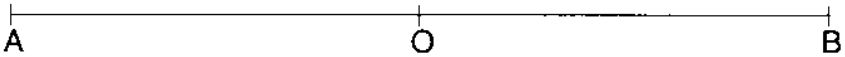
Réponds oui ou non